Les solides

Je comprends

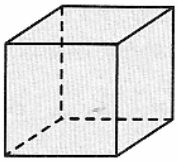

Un **cube**



Un **pavé droit**

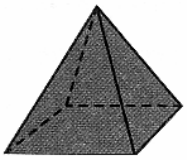

Une **pyramide**

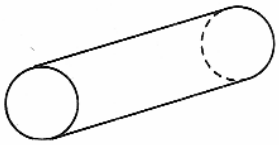

Un **cylindre**



Un **cône**



Une **sphère**

Je m'entraîne

1 * **Relie** chaque objet au solide qui a la même forme, puis **écris** le nom des solides.





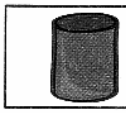

Un **cylindre**

Une **sphère**

Un **pavé droit**

Une **pyramide**

Un **cube**

Un **cône**

2 ** **Observe** le dessin et **écris** dans le tableau le nombre de solides de chaque type.



Cylindre	1
Pavé droit	3
Sphère	1
Pyramide	3
Cône	1